Apple delivery orders



Count the apples in each group. Add them to fill the order.

 +  = _____

 +  = _____

 +  = _____

 +  = _____